O. P. JINDAL SCHOOL, SAVITRI NAGAR

Periodic Test -1(Round - 2) (2026 – 27)

Class / Section: II (___) **MM: 20**

Subject: Mathematics **Time: 1Hr.**

Name: _____ Roll No.:_____

Invigilator's Sign: _____ Marks Obtained: _____ Examiner's Sign:_____

1) Write the number of faces and edges in the following. (4 Marks)

Object	Number of edges	Number of faces
Cylinder		
Cube		

2) Make groups of tens and fill in the boxes. (1 Marks)

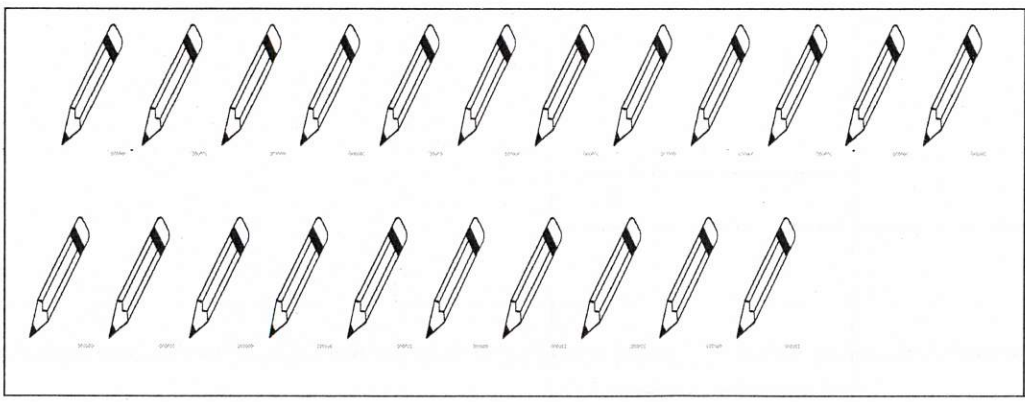

Group of tens	Loose items

3) Name any two objects which have – (3 Marks)

	A	B
No corner		
Four corners		
One corner		

4) Tick (√) the correct answers. (2 Marks)

i) Similar in shape to a 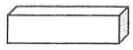 .

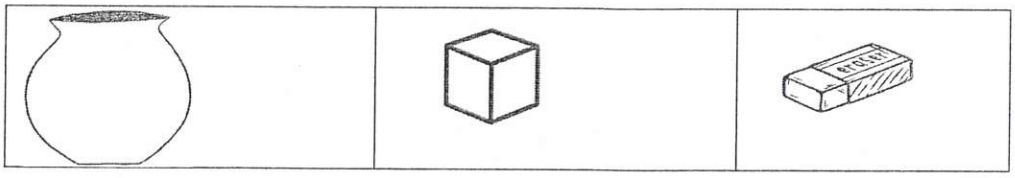

ii) Similar in shape to a  .

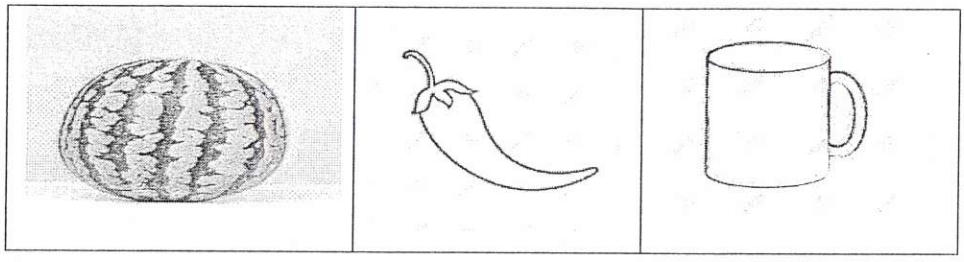

5) Write the name of the shapes. (4Marks)

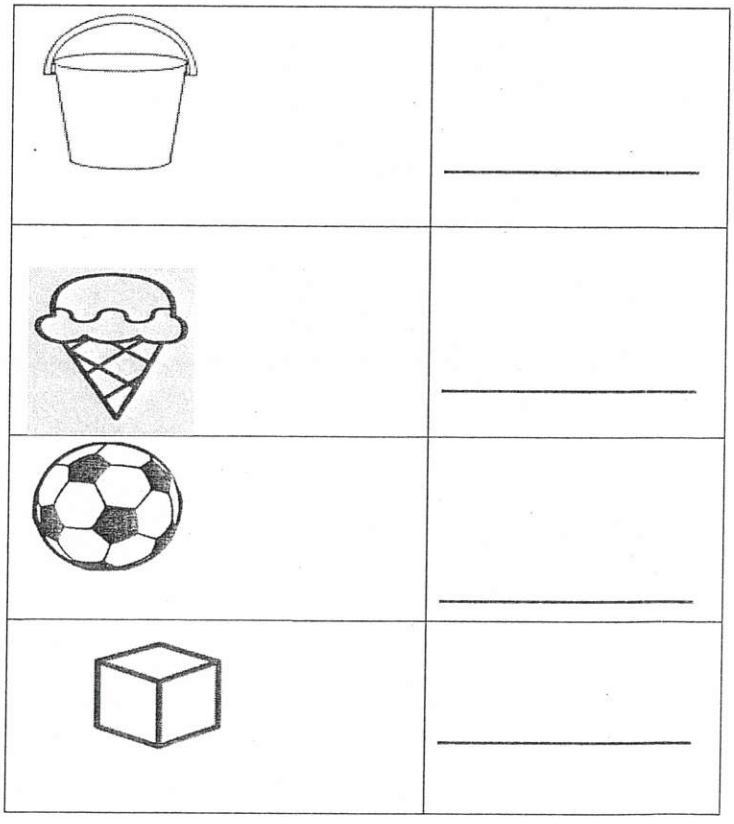

6) Count and write the correct number of these shapes in the following image.

(2 Marks)

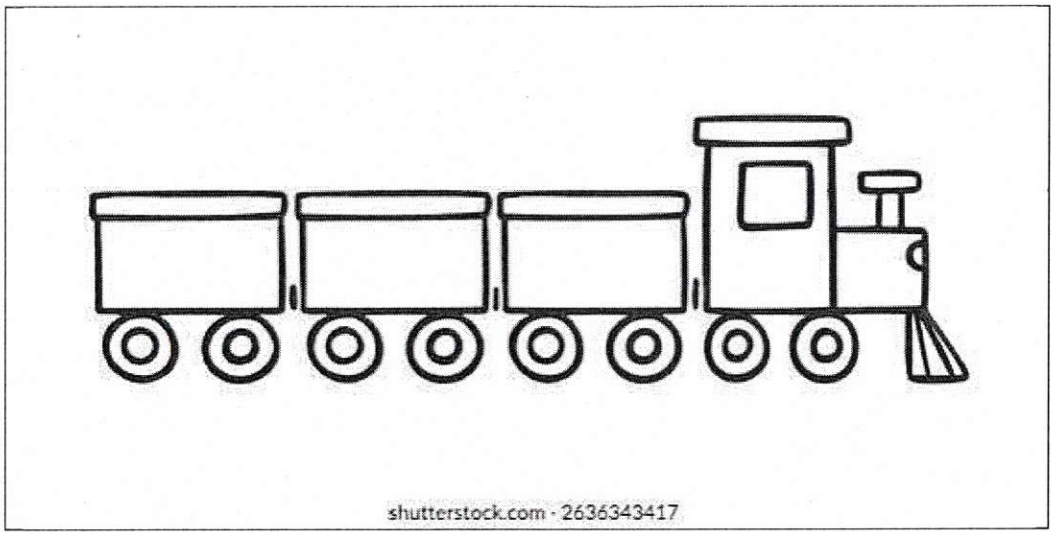

Triangle _____ Rectangle _____ Circle _____Square_____

7) Encircle the smaller number. **(2 Marks)**

i) 58 60 ii) 43 33

8) Write the following numbers in the circles , from the greatest to the smallest.

64 87 99 **(2 Marks)**

Greatest 29 44 30 Smallest

